Finding Distance on a Grid

Name:

Find the distance between points.

Ex)

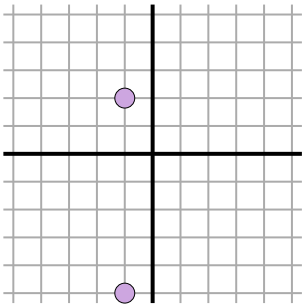

1)

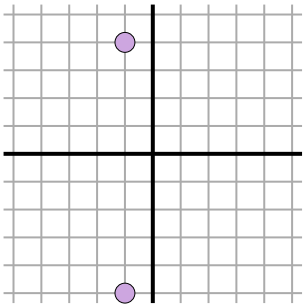

2)

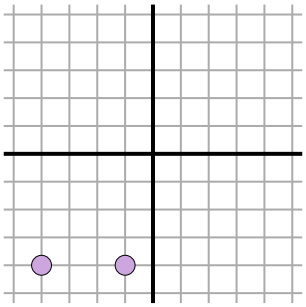

3)

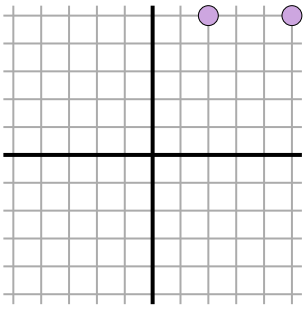

4)

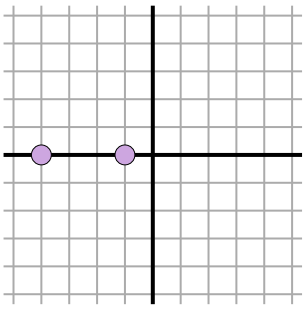

5)

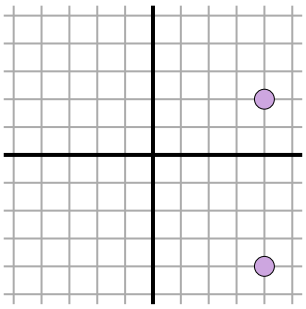

6)

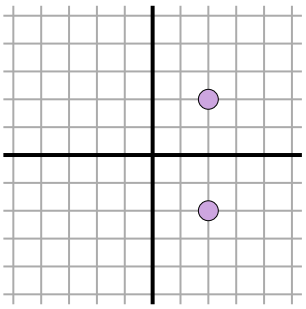

7)

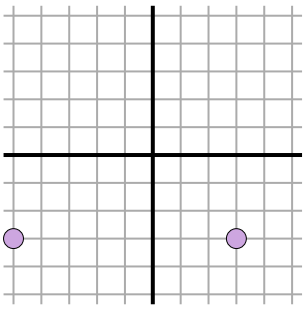

8)

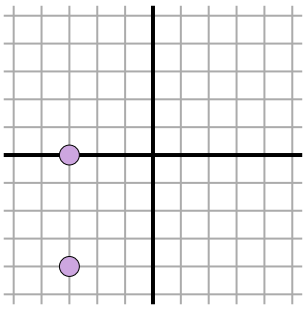

9)

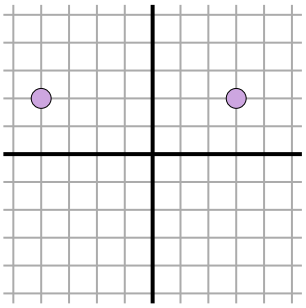

10)

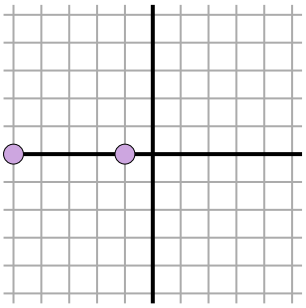

11)

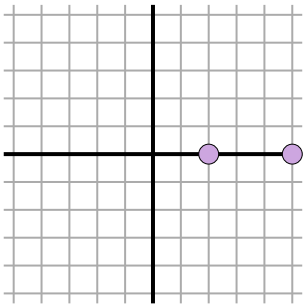

Answers

Ex. 7

1. _____

2. _____

3. _____

4. _____

5. _____

6. _____

7. _____

8. _____

9. _____

10. _____

11. _____

1-10	91	82	73	64	55	45	36	27	18	9
11	0									

Finding Distance on a Grid

Name: **Answer Key**

Find the distance between points.

Ex)

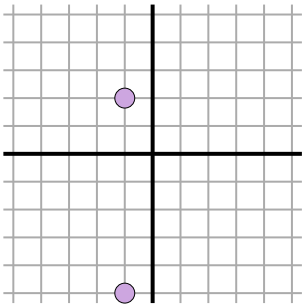

$\sqrt{(-1--1)^2 + (-5-2)^2}$

$\sqrt{(0) + (49)}$

1)

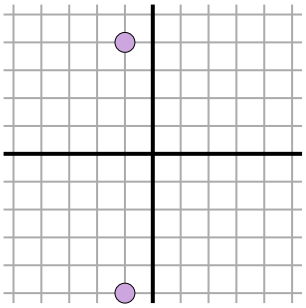

$\sqrt{(-1--1)^2 + (4--5)^2}$

$\sqrt{(0) + (81)}$

2)

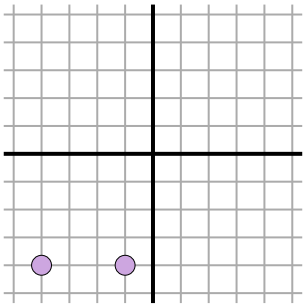

$\sqrt{(-1--4)^2 + (-4--4)^2}$

$\sqrt{(9) + (0)}$

3)

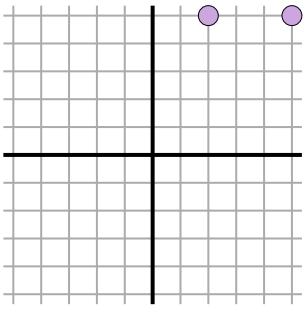

$\sqrt{(5-2)^2 + (5-5)^2}$

$\sqrt{(9) + (0)}$

4)

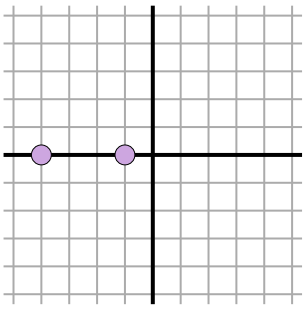

$\sqrt{(-4--1)^2 + (0-0)^2}$

$\sqrt{(9) + (0)}$

5)

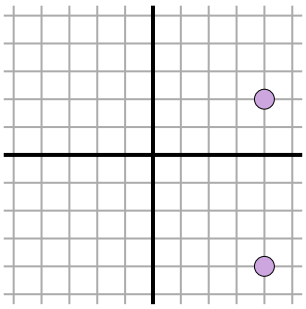

$\sqrt{(4-4)^2 + (2--4)^2}$

$\sqrt{(0) + (36)}$

6)

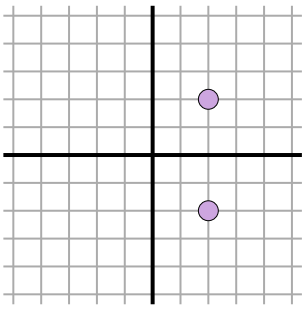

$\sqrt{(2-2)^2 + (2--2)^2}$

$\sqrt{(0) + (16)}$

7)

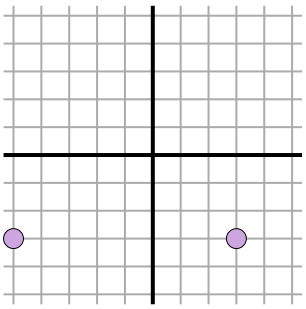

$\sqrt{(-5-3)^2 + (-3--3)^2}$

$\sqrt{(64) + (0)}$

8)

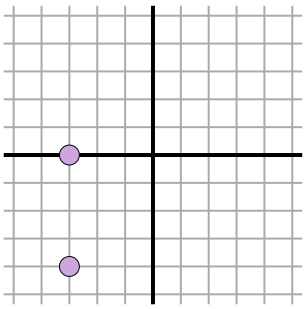

$\sqrt{(-3--3)^2 + (0--4)^2}$

$\sqrt{(0) + (16)}$

9)

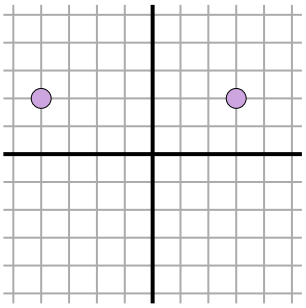

$\sqrt{(-4-3)^2 + (2-2)^2}$

$\sqrt{(49) + (0)}$

10)

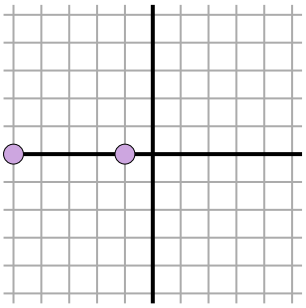

$\sqrt{(-5--1)^2 + (0-0)^2}$

$\sqrt{(16) + (0)}$

11)

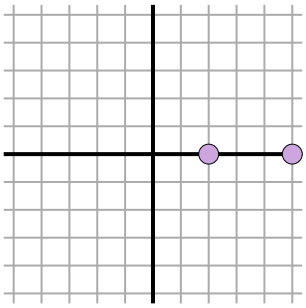

$\sqrt{(5-2)^2 + (0-0)^2}$

$\sqrt{(9) + (0)}$

Answers

Ex.	7
1.	9
2.	3
3.	3
4.	3
5.	6
6.	4
7.	8
8.	4
9.	7
10.	4
11.	3

1-10	91	82	73	64	55	45	36	27	18	9
11	0									